Bright Path Sped

12 MENUS

3 LEVELS

82 PAGES

My name _____ Date _____

Blue Door Pizza Menu

Read the menu. Answer the four questions.

Blue Door Pizza

Pizza

A Cheese Slice	B Pepperoni Slice	C Mini Pizza
3 dollars	4 dollars	9 dollars

Sides and Drinks

D Garlic Bread	E Side Salad	F Lemonade
2 dollars	6 dollars	1 dollar

All prices are in dollars.

1. How much is the cheese slice? ____
2. How much is the lemonade? ____
3. Which item costs 9? Write its letter. ____
4. Which costs more, the mini pizza or the lemonade? Write its letter. ____

Menu Math - Blue Door Pizza Menu

MENU MATH

Ordering, Adding Prices, Counting Money - Grades 2-5

Terms of Use

Please read before you print your first page.

One classroom license

- This file is for one classroom: one teacher, one group of students.
- Please do not share it, post it online, or sell it.
- Extra licenses for a team or a school are available on the product page.

This is a fillable PDF

- Open it in a PDF reader (Adobe Acrobat Reader, Preview, or your browser), click into a line or a box, type, and Save As.
- The name line, every answer box, every ruled work box, every check box and every table cell on the student pages are type-in fields, and so are the tracker, class grid, team note and family page. You can also print any page and write by hand.
- It works offline. No account, no subscription, no internet connection needed after you download it.

Print at 100 percent

Turn off fit to page and shrink to fit so the ruled lines stay 0.34 inch apart. Every student page is readable in black and white inside a colored border, so it still reads when copied in black and white. Every bill and coin carries its number, and every price is written in numbers.

Student work

A filled-in tracker, class grid or team note carries a real student's name. Keep it in the data folder, and use a first name only on any page that leaves your hands.

Need help?

If a field will not behave or a page will not print the way you expect, use Ask a Question on the product page. Every question is read, and a fix ships as a free update.

© Bright Path Sped. For single-classroom use by the original purchaser.

PREVIEW

Preview - Bright Path Sped

My name _____ Date _____

How to Read a Menu

Read each part of the menu. Then try it.

Blue Door Pizza

prices are in dollars

Pizza



Cheese Slice — A — 3



Pepperoni Slice — B — 4



Mini Pizza — C — 9

Sides and Drinks



Garlic Bread — D — 2



Side Salad — E — 6



Lemonade — F — 1

Look at the parts of this menu.

Blue Door Pizza	the name of the place
Pizza	a group of items
A	the letter: use it to name the item
 Pepperoni Slice	the picture and the name of the item
4	the price, in dollars

To order and pay:

1	2	3	4	5
Read the menu.	**Pick two items.**	**Add the two prices.**	**Count your money.**	**Find your change.**

Try it on the menu above:

1. How much is the cheese slice? _____
2. Which letter is the lemonade? _____
3. What is the total for the cheese slice and the lemonade? _____

PREVIEW

Preview - Bright Path Sped

My name _____ Date _____



Menu Words

Read the word bank. Write the missing word.

change	menu	order	pay	price	total

1. A ____ shows the food you can buy and the prices. ____

2. The ____ tells how much one item costs. ____

3. When you add all the prices, you get the ____. ____

4. You ____ food by telling the cashier what you want. ____

5. You ____ for your food with money. ____

6. If you pay with more than the total, you get ____ back. ____

PREVIEW

Preview - Bright Path Sped

My name _____ Date _____

Count the Payment Level 2 A



Count the money. Write the total.

Count the bills first. Then count the quarters: 4 quarters make 1 dollar. Write cents with a point: 3 quarters is 0.75.

1

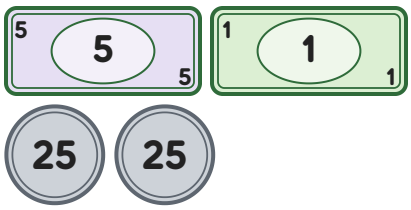

Total _____ dollars

2

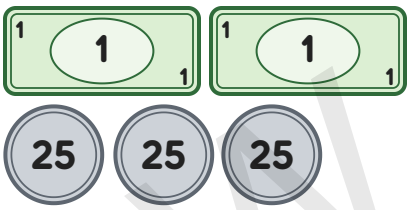

Total _____ dollars

3

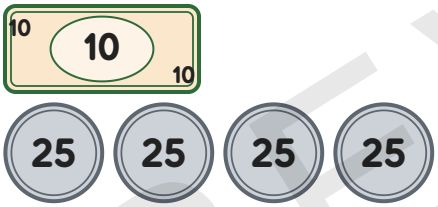

Total _____ dollars

4

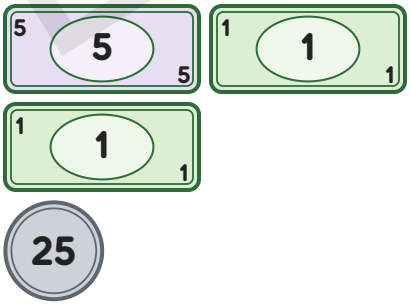

Total _____ dollars

5

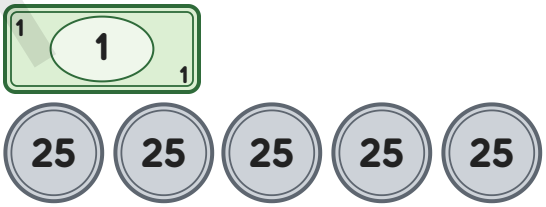

Total _____ dollars

6

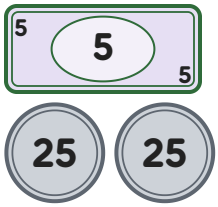

Total _____ dollars

Which pile was hardest to count? How did you count it?

PREVIEW

My name _____ Date _____

Blue Door Pizza

Set 1

Read the menu. Add. Count your money.

Blue Door Pizza

prices are in dollars

Pizza



Cheese Slice (A) 3



Pepperoni Slice (B) 4



Mini Pizza (C) 9

Sides and Drinks



Garlic Bread (D) 2



Side Salad (E) 6



Lemonade (F) 1

1. How much is the side salad? _____
2. How much is the garlic bread? _____
3. Which item costs the most? Write its letter. _____
4. Which item costs 4? Write its letter. _____

1 Order 1

You order the Cheese Slice (A) and the Garlic Bread (D).

Total _____

Show your work

You pay with:

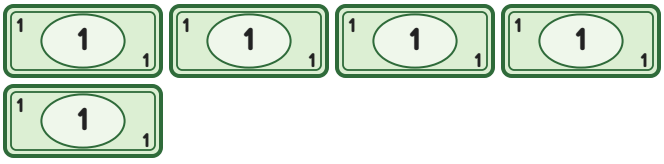

I count _____

2 Order 2

You order the Pepperoni Slice (B) and the Side Salad (E).

Total _____

Show your work

You pay with:

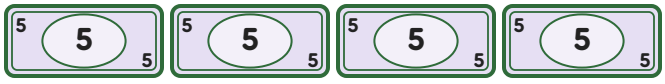

I count _____

PREVIEW

My name _____ Date _____

Maple Street Pancakes

Set 1

Read the menu. Add. Count your money.

Maple Street Pancakes

prices are in dollars

Breakfast



Pancakes (A) 6



Waffle (B) 7



Egg Plate (C) 9

Extras



Toast (D) 1



Bacon (E) 4



Orange Juice (F) 2

1. How much is the orange juice? _____
2. How much is the bacon? _____
3. Which item costs the most? Write its letter. _____
4. Which item costs 9? Write its letter. _____

1 Order 1

You order the Egg Plate (C) and the Orange Juice (F).

Total _____

Show your work

You pay with:

5 5 5 5 5 5 5 5

I count _____

2 Order 2

You order the Pancakes (A) and the Bacon (E).

Total _____

Show your work

You pay with:

5 5 5 5 5 5

I count _____

PREVIEW

My name _____ Date _____

Dockside Fish and Chips

Set 2

Read the menu. Add. Count your money.

Dockside Fish and Chips

prices are in dollars

Baskets



Fish Basket (A) 9



Shrimp Basket (B) 12



Chowder Cup (C) 5

Sides and Drinks



Fries (D) 3



Lemonade (E) 4



Iced Tea (F) 1

1. How much is the lemonade? _____
2. Which item costs 5? Write its letter. _____
3. Which item costs the least? Write its letter. _____
4. Which costs more, the fries or the fish basket? Write its letter. _____

1 Order 1

You order the Fish Basket (A) and the Iced Tea (F).

Total _____

Show your work

You pay with:

5 | 5 | 5 | 5 | 5 | 5

I count _____

2 Order 2

You order the Shrimp Basket (B) and the Fries (D).

Total _____

Show your work

You pay with:

10 | 10 | 10 | 10 | 5 | 5

I count _____

PREVIEW

My name _____ Date _____

Ballpark Snack Stand

Set 2

Read the menu. Add. Count your money.

Ballpark Snack Stand

prices are in dollars

Snacks



Hot Dog (A) 4



Nachos (B) 6



Pretzel (C) 3

Drinks and More



Popcorn (D) 5



Water (E) 1



Soda (F) 7

1. How much is the soda? _____
2. Which item costs 5? Write its letter. _____
3. Which item costs the least? Write its letter. _____
4. Which costs more, the water or the nachos? Write its letter. _____

1 Order 1

You order the **Pretzel** (C) and the **Water** (E).

Total _____

Show your work

You pay with:



I count _____

2 Order 2

You order the **Hot Dog** (A) and the **Popcorn** (D).

Total _____

Show your work

You pay with:

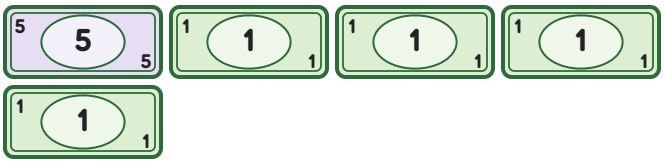

I count _____

PREVIEW

Preview - Bright Path Shed

My name _____ Date _____

Green Spoon Soup and Salad

Set 3

Read the menu. Add. Count your money.

Green Spoon Soup and Salad

prices are in dollars

Soups



Tomato Soup (A) 3.25



Chicken Soup (B) 3.75



Corn Chowder (C) 4.25

Salads and Sides



Garden Salad (D) 4.75



Fruit Salad (E) 3.50



Dinner Roll (F) 1.25

1. How much is the dinner roll? _____
2. How much more is the chicken soup than the fruit salad? _____
3. Which costs less, the garden salad or the tomato soup? Write its letter. _____
4. Which item costs 4.75? Write its letter. _____

1 Order 1

You order the Tomato Soup (A) and the Fruit Salad (E).

Total _____

Show your work

You pay with:

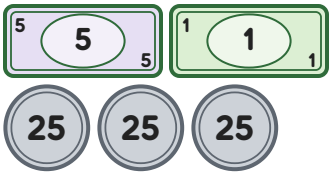

I count _____

2 Order 2

You order the Chicken Soup (B) and the Dinner Roll (F).

Total _____

Show your work

You pay with:

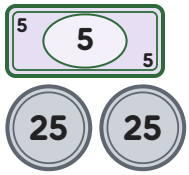

I count _____

PREVIEW

Preview - Bright Path Shed

My name _____ Date _____

Cedar Creek Sandwiches

Set 3

Read the menu. Add. Count your money.

Cedar Creek Sandwiches

prices are in dollars

Sandwiches



Turkey Sandwich (A) 5.25



Veggie Wrap (B) 4.75



Cheese Sandwich (C) 3.50

Sides and Drinks



Chips (D) 1.25



Cookie (E) 1.00



Milk (F) 1.75

1. How much is the turkey sandwich? _____
2. How much more is the cheese sandwich than the milk? _____
3. Which costs less, the cookie or the veggie wrap? Write its letter. _____
4. Which item costs 1.00? Write its letter. _____

1 Order 1

You order the Cheese Sandwich (C) and the Chips (D).

Total _____

Show your work

You pay with:

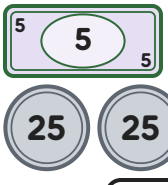

I count _____

2 Order 2

You order the Turkey Sandwich (A) and the Milk (F).

Total _____

Show your work

You pay with:

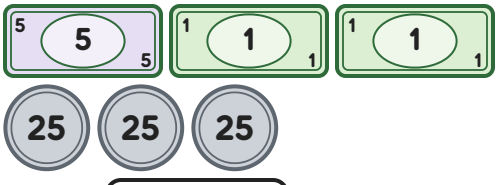

I count _____

PREVIEW

Preview - Bright Path Shed

My name _____ Date _____

Penny Scoop Ice Cream

Set 3

Read the menu. Add. Count your money.

Penny Scoop Ice Cream

prices are in dollars

Treats



One Scoop (A) 2.25



Sundae (B) 4.50



Milkshake (C) 5.25

Extras



Ice Pop (D) 0.75



Cookie (E) 1.25



Water (F) 1.00

1. How much is the sundae? _____
2. How much more is the one scoop than the ice pop? _____
3. Which costs less, the water or the milkshake? Write its letter. _____
4. Which item costs 1.00? Write its letter. _____

1 Order 1

You order the Sundae (B) and the Ice Pop (D).

Total _____

Show your work

You pay with:





I count _____

2 Order 2

You order the Milkshake (C) and the Cookie (E).

Total _____

Show your work

You pay with:





I count _____

PREVIEW

Preview - Bright Path Shop

My name _____ Date _____

Fiesta Corner Tacos Menu

Read the menu. Answer the four questions.

Fiesta Corner Tacos

Plates



A Taco

2.35 dollars



B Burrito

5.60 dollars



C Nachos

3.90 dollars

Sides and Drinks



D Rice Cup

1.15 dollars



E Lemonade

1.85 dollars



F Churro

2.40 dollars

All prices are in dollars.

1. How much are the nachos? _____
2. How much is the burrito? _____
3. Which item costs 1.85? Write its letter. _____
4. Which costs more, the lemonade or the burrito? Write its letter. _____

PREVIEW

Preview - Bright Path Shop

My name _____ Date _____

Little Lantern Noodles Menu

Read the menu. Answer the four questions.

Little Lantern Noodles

Bowls



A Noodle Bowl

5.85 dollars



B Fried Rice

4.65 dollars



C Dumplings

3.95 dollars

Sides and Drinks



D Egg Roll

1.55 dollars



E Green Tea

1.95 dollars



F Fortune Cookie

0.45 dollars

PREVIEW

All prices are in dollars.

1. How much is the egg roll? _____
2. How much are the dumplings? _____
3. Which item costs 0.45? Write its letter. _____
4. Which costs more, the fortune cookie or the dumplings? Write its letter. _____

Preview - Bright Path Shop

My name _____ Date _____

Berry Good Smoothies

Set 1 ▲

Read the menu. Add. Count your money. Find the change.

Berry Good Smoothies

prices are in dollars

Smoothies



Strawberry Smoothie (A) 4.85



Mango Smoothie (B) 5.15



Green Smoothie (C) 5.65

Snacks



Granola Bar (D) 1.45



Yogurt Cup (E) 2.25



Muffin (F) 2.95

1. How much is the green smoothie? _____
2. How much is the mango smoothie? _____
3. Which item costs the most? Write its letter. _____
4. Which item costs 2.95? Write its letter. _____

1 Order 1

You order the **Green Smoothie** (C) and the **Muffin** (F).

Total _____

Show your work

You pay with:

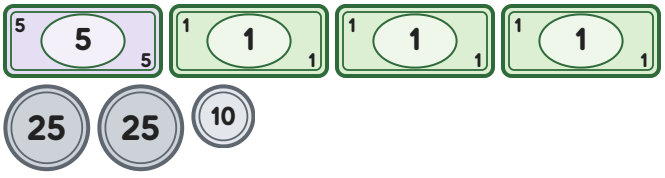

I count _____ **Change** _____

2 Order 2

You order the **Strawberry Smoothie** (A) and the **Yogurt Cup** (E).

Total _____

Show your work

You pay with:

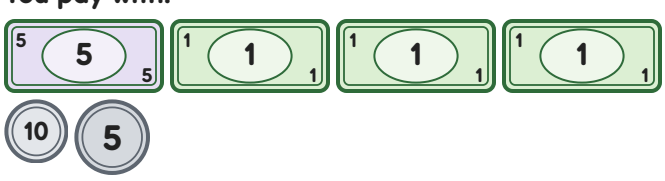

I count _____ **Change** _____

PREVIEW

Preview - Bright Path Shop

My name _____ Date _____

Sunny Hill Diner

Set 1 ▲

Read the menu. Add. Count your money. Find the change.

Sunny Hill Diner

prices are in dollars

Meals



Burger (A) 6.45



Grilled Cheese (B) 4.85



Chicken Strips (C) 5.95

Sides and Drinks



Fries (D) 2.35



Milk (E) 1.65



Apple Juice (F) 1.90

1. How much are the fries? _____
2. How much are the chicken strips? _____
3. Which item costs the most? Write its letter. _____
4. Which item costs 6.45? Write its letter. _____

1 Order 1

You order the Grilled Cheese (B) and the Apple Juice (F).

Total _____

Show your work

You pay with:

5 5 5 | 1 1 1 | 1 1 1

25 25 10 10

I count _____ **Change** _____

2 Order 2

You order the Chicken Strips (C) and the Fries (D).

Total _____

Show your work

You pay with:

5 5 5 | 1 1 1 | 1 1 1 | 1 1 1

25 5

I count _____ **Change** _____

PREVIEW

My name _____ Date _____

Order From My Menu

Order two items. Add. Count. Write the change.

Use the menu you made. A friend picks two items. Add the prices.

1 **Item** _____ **price** _____

Item _____ **price** _____

Total _____ **I pay** _____ **Change** _____

2 **Item** _____ **price** _____

Item _____ **price** _____

Total _____ **I pay** _____ **Change** _____

3 **Item** _____ **price** _____

Item _____ **price** _____

Total _____ **I pay** _____ **Change** _____

PREVIEW

Answer Key: Level 1, Bills

All twelve worksheets, in page order. The menu reading pages are on page 72.

Worksheet (page)	1	2	3	4	Order 1: total, count	Order 2: total, count
Blue Door Pizza, Set 1 (p16)	6	2	C	B	5 / 5	10 / 20
Blue Door Pizza, Set 2 (p17)	9	A	F	E	10 / 15	9 / 15
Blue Door Pizza, Set 3 (p18)	4	1	F	F	5 / 5	11 / 20
Maple Street Pancakes, Set 1 (p20)	2	4	C	C	11 / 20	10 / 15
Maple Street Pancakes, Set 2 (p21)	1	B	D	C	9 / 15	10 / 15
Maple Street Pancakes, Set 3 (p22)	9	3	D	A	8 / 15	8 / 8
Dockside Fish and Chips, Set 1 (p24)	9	1	B	D	13 / 13	8 / 15
Dockside Fish and Chips, Set 2 (p25)	4	C	F	A	10 / 15	15 / 25
Dockside Fish and Chips, Set 3 (p26)	3	4	E	B	9 / 9	12 / 20
Ballpark Snack Stand, Set 1 (p28)	6	4	F	E	11 / 20	11 / 11
Ballpark Snack Stand, Set 2 (p29)	7	D	E	B	4 / 15	9 / 9
Ballpark Snack Stand, Set 3 (p30)	1	1	C	C	7 / 15	10 / 15

PREVIEW

Reading this key

The numbers 1 to 4 are the four menu questions in order (a letter or a price). Then each order gives the total, then what the student should count in the payment. Every payment is at least the total, so no order is short. Accept a price with or without the cents when the price is a whole number.

Menu Math Tracker

One student, every scored page. Write how many items were right with no prompt; blank means not tried. Filled example: page 78. Keys: pages 69 to 73.

Student _____ Teacher _____ Month _____

Page type	Items	Right	Date	Notes
Know Your Money (p8)	4			
How to Read a Menu (p6)	3			
Menu Words (p7)	6			
Count the Payment, Level 1 (p9 to 10)	12			
Count the Payment, Level 2 (p11 to 12)	12			
Count the Payment, Level 3 (p13 to 14)	12			
Change Back (p63)	8			
Menu Math Quiz (p66)	7			

Menu: reading page, Sets 1 to 3	Reading	Set 1	Set 2	Set 3
Blue Door Pizza (p15 to 18) of 4, 8, 8, 8				
Maple Street Pancakes (p19 to 22) of 4, 8, 8, 8				
Dockside Fish and Chips (p23 to 26) of 4, 8, 8, 8				
Ballpark Snack Stand (p27 to 30) of 4, 8, 8, 8				
Green Spoon Soup and Salad (p31 to 34) of 4, 8, 8, 8				
Cedar Creek Sandwiches (p35 to 38) of 4, 8, 8, 8				
Penny Scoop Ice Cream (p39 to 42) of 4, 8, 8, 8				
Golden Crust Bakery (p43 to 46) of 4, 8, 8, 8				
Fiesta Corner Tacos (p47 to 50) of 4, 10, 10, 10				
Little Lantern Noodles (p51 to 54) of 4, 10, 10, 10				
Berry Good Smoothies (p55 to 58) of 4, 10, 10, 10				
Sunny Hill Diner (p59 to 62) of 4, 10, 10, 10				

This month we are working on (your own goal or wording)

PREVIEW

Riley's Tracker (Invented Student)

Riley S. is invented; nothing on this page describes a real student. The blank tracker is on page 74.

Student	Teacher	Month
Riley S. (an invented student)	Ms. Alvarez (invented)	September to October

Page type	Items	Right	Date	Notes
Know Your Money (p8)	4	4	9/22	-
Menu Words (p7)	6	5	9/24	Mixed up price and total
Count the Payment, Level 1 (p9 to 10)	12	11	9/26	Missed one bill
Count the Payment, Level 2 (p11 to 12)	12	8	10/1	Counted quarters as dimes
How to Read a Menu (p6)	3	-	-	-
Count the Payment, Level 3 (p13 to 14)	12	-	-	-
Change Back (p63)	8	-	-	-
Menu Math Quiz (p66)	7	-	-	-

Menu	Reading	Set 1	Set 2	Set 3
Blue Door Pizza of 4, 8, 8, 8	4	8	7	-
Maple Street Pancakes of 4, 8, 8, 8	4	8	-	-
Dockside Fish and Chips of 4, 8, 8, 8	-	-	-	-
Ballpark Snack Stand of 4, 8, 8, 8	-	-	-	-
Green Spoon Soup and Salad of 4, 8, 8, 8	3	6	-	-
Cedar Creek Sandwiches of 4, 8, 8, 8	-	-	-	-
Penny Scoop Ice Cream of 4, 8, 8, 8	-	-	-	-
Golden Crust Bakery of 4, 8, 8, 8	-	-	-	-
Fiesta Corner Tacos of 4, 10, 10, 10	-	-	-	-
Little Lantern Noodles of 4, 10, 10, 10	-	-	-	-
Berry Good Smoothies of 4, 10, 10, 10	-	-	-	-
Sunny Hill Diner of 4, 10, 10, 10	-	-	-	-

How to read it

Riley S. has done **13 of 59** scored pages and got **68 of 78** items right with no prompt. **5** of 11 rows are all right and **6** carry a note. Every number comes from the tables.

What the tables point to

The lowest row is Count the Payment, Level 2 (8 of 12), so the next practice goes to counting quarters. A dash means not tried yet, never wrong.

PREVIEW